Flashback 4

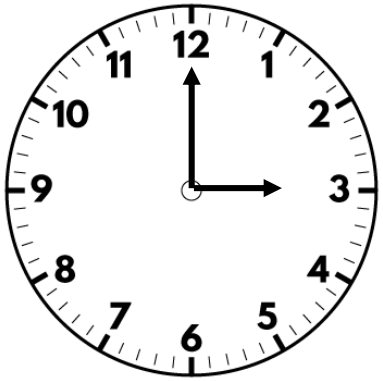

1) Which shape comes next in the pattern?

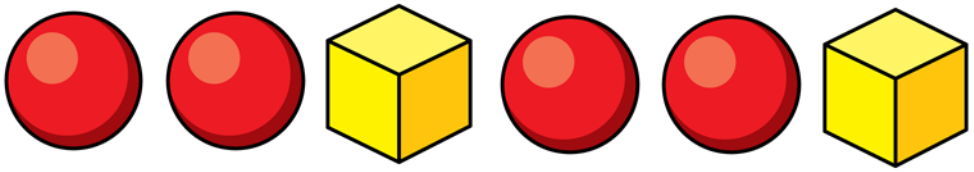

sphere

2) How many faces does the shape have?

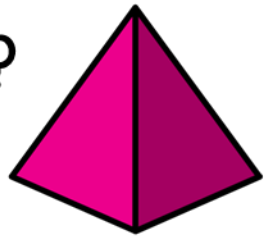

5

3) If  = 10 people, how many people does this represent?

50

4) 30 + $\boxed{27}$ = 57

Flashback 4

Year 2 | Week 8 | Day 2

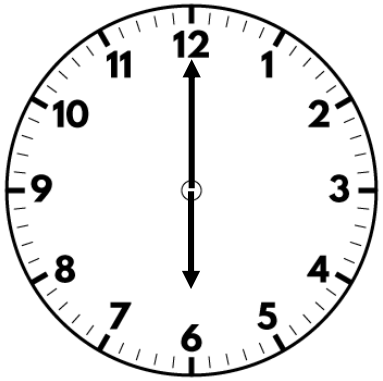

1) Does the shape show equal parts?

No

2) How many edges does the shape have?



9

3) How many people like apple most?

Apple	● ●
Banana	● ● ● ●
Pear	● ● ●

● = 2 people

4 people

4) What is 10 more than 63? 73

Flashback 4

Year 2 | Week 8 | Day 3



1) How many groups of 3 can you make?



4 groups of 3

2) How many vertices does the shape have?

8

3) How many more people like green than blue?

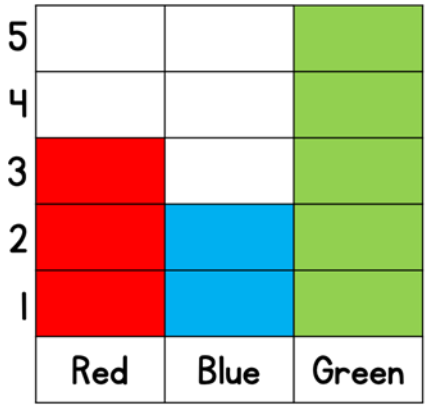

3 people

4) How much money is there?

2 pounds and 35 pence

White Rose Maths

Flashback 4

Year 2 | Week 8 | Day 4



1) Which pictures show $\frac{1}{2}$?

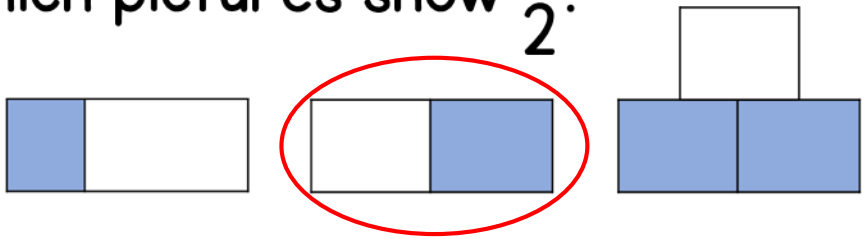

2) How have the shapes been sorted?

curved surfaces and flat surfaces

3) What shape is the tin?

cylinder

4) What multiplications are shown by the array?



5×3 and 3×5

Flashback 4

Year 2 | Week 8 | Day 5

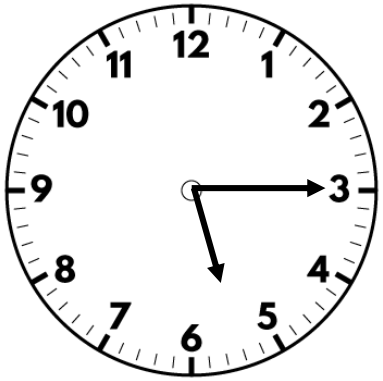

1) How many sweets are half the sweets?

3

2) What is the name of the next shape in the pattern?

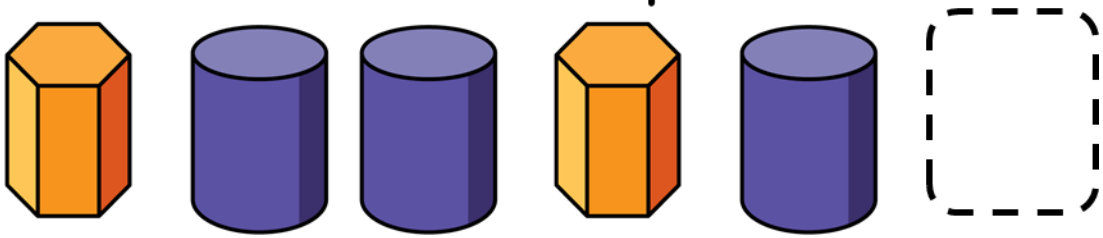

cylinder

3) How many sides does a hexagon have? 6

4) 20 counters are shared into 5 equal groups.
How many counters are in each group? 4 counters

Flashback 4

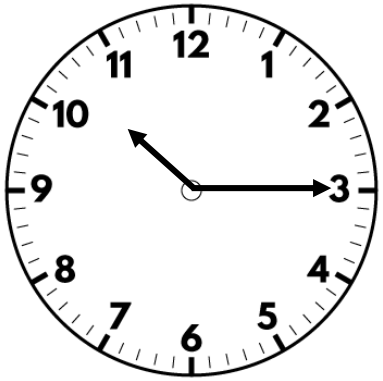

1) What is each part of the circle worth?

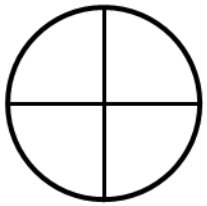

$\frac{1}{4}$

2) Is the shape split into equal parts?

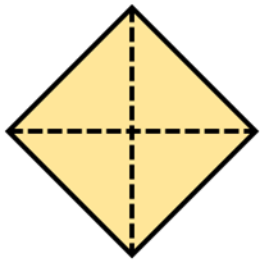

Yes

3) What 2-D shape has 3 vertices? triangle

4) What's wrong with the pictogram?

Apple	
Banana	
Pear	

The circles are different sizes, they are not spread out evenly and there is no key.

White Rose Maths

Flashback 4



1) What is one quarter of 20?
Write your answer in words. Five

2) True or false? $\frac{1}{2}$ is shaded.

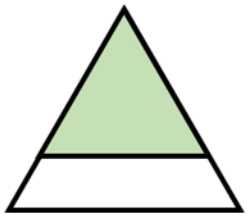

False

3) Draw a rectangle.

4) What is the next number in the sequence?
25, 30, 35, ... 40

Flashback 4



1) Does the picture show $\frac{1}{3}$ shaded?

Yes, 1 out of 3 equal parts is shaded

2) Work out one half of 24 12

3) Is the line of symmetry correct?

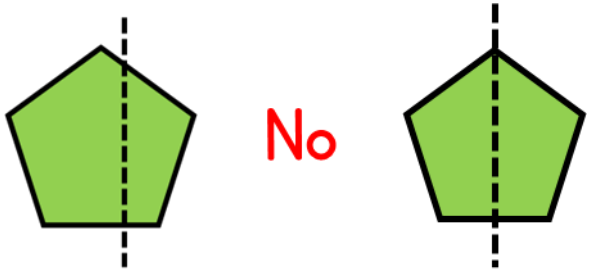

No

4) Work out 27 + 9 36

Flashback 4

Year 2 | Week 9 | Day 4

1) Eva gives a third of her money away.

How much money does she give away?

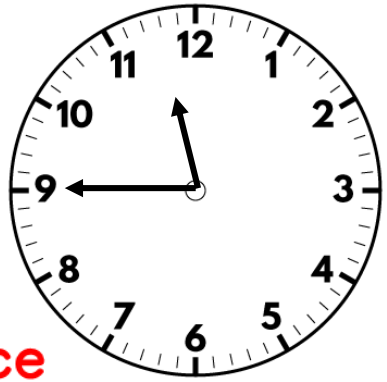

3 pence

2) What fraction of the triangle is shaded?

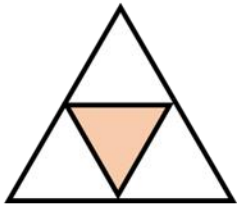

$\frac{1}{4}$

3) How have the shapes been sorted?

3-sided shapes and

4-shapes shapes

4) How much money is there?

19 pounds and 3 pence

White Rose Maths

Flashback 4

Year 2 | Week 9 | Day 5



1) What is $\frac{1}{3}$ of 18? 6

2) What is $\frac{1}{4}$ of the counters?



3

3) How many sides does the next shape have?



3

4) Are the groups equal? Yes there is 5 pounds in each group.

White Rose Maths

Flashback 4

Year 2 | Week 10 | Day 1



1) What fraction of the cakes are chocolate?

$\frac{1}{4}$

2) Which have one third shaded?

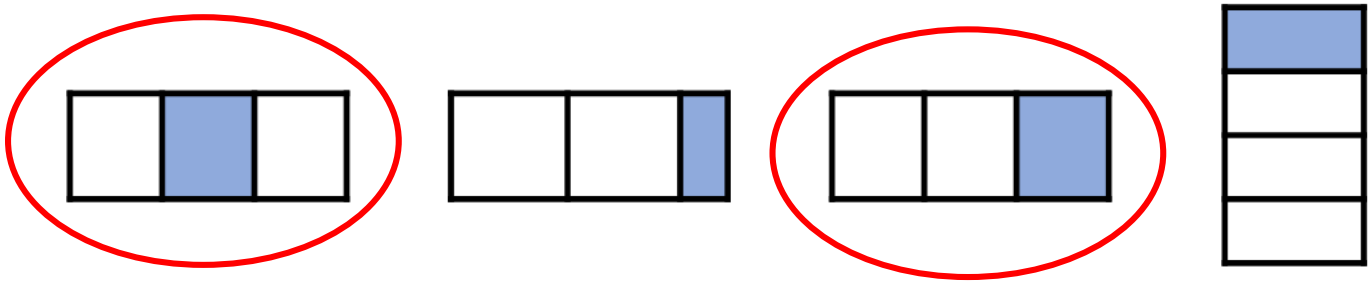

3) How many faces does a cuboid have? 6

4) What is 45 divided by 5? 9

Flashback 4

Year 2 | Week 10 | Day 2



1) What fraction of the fruit are pears?



$\frac{2}{3}$

2) $\frac{1}{3}$ of $\boxed{15} = 5$

3) How many edges does a cube have? 12

4) If  represents 10 sweets, what does this represent?



35 sweets

White Rose Maths

Flashback 4

Year 2 | Week 10 | Day 3

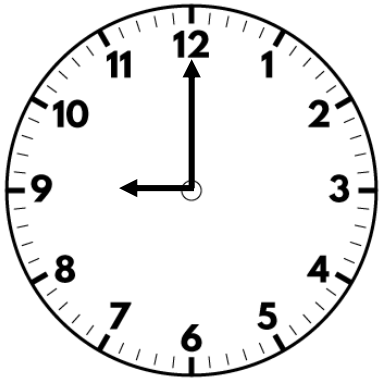

1) What fraction of the shape is shaded?

Write your answer in two ways.



$\frac{2}{4}$ or $\frac{1}{2}$

2) What unit fraction is represented?

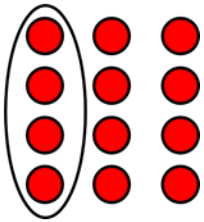

$\frac{1}{3}$

3) How have the shapes been sorted?

Triangular faces and non-triangular faces

4) What is the missing number?

15, 12, $\boxed{9}$, 6, 3

White Rose Maths

Flashback 4

Year 2 | Week 10 | Day 4

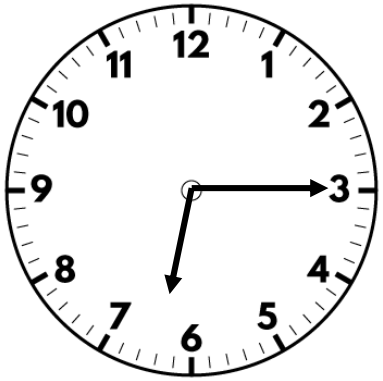

1) What is $\frac{3}{4}$ of 16? 12

2) What fraction is shaded?

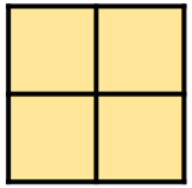

$\frac{4}{4}$

3) How many edges does the next shape have?

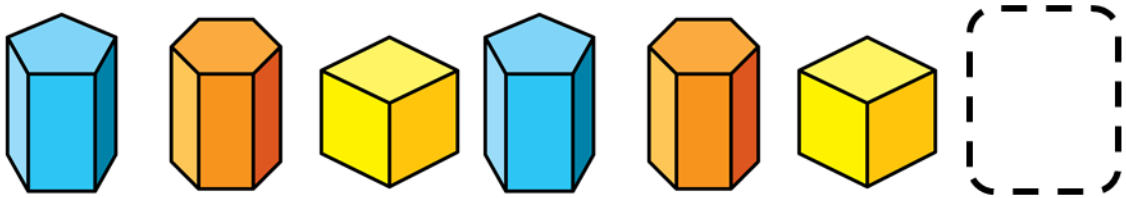

15

4) Work out the missing number.

$100 - \boxed{63} = 37$

Flashback 4

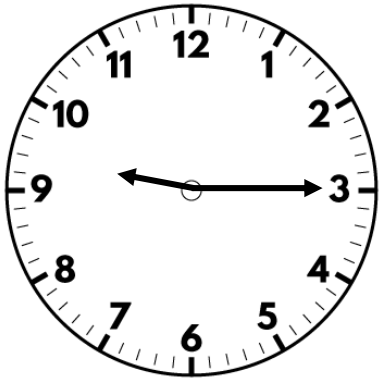

1) Continue counting in thirds.

$\frac{1}{3}, \frac{2}{3}, \frac{3}{3}, \frac{4}{3}, \frac{5}{3}$

2) $\frac{2}{4}$ of 30 = 15

3) How many vertices does a cone have? 1

4) Ron has £1

He buys a chocolate bar for 57p.

How much change does he get? 43p